Archimedean Pre-K

30 ΜΑΡΤΙΟΥ ΕΩΣ 3 ΑΠΡΙΛΙΟΥ 2026

ΟΝΟΜΑ:_____

Αυτή την εβδομάδα μαθαίνουμε….

*Language:
-The letter: Φ ϕ
Listening, Speaking, Reading, Writing.
*Mathematics:
Counting and matching strategies, constructing sets, comparing quantities, ordering numbers, composing and decomposing numbers, comparing numbers, addition, measurements, subtraction

Homework 22 Sect. 1

ΜΕΙΟΝ	**-**
μηδέν	0
ΦΙ	**Φ ϕ**
Φάκελος	
ΦΙ	**Φ ϕ**
φωτογραφία	

Πηγές (Resources)

*The Homework 22 Guide

Εργασία στο σπίτι

ΔΕΥΤΕΡΑ	ΤΡΙΤΗ	ΤΕΤΑΡΤΗ	ΠΕΜΠΤΗ	ΠΑΡΑΣΚΕΥΗ
Section 1 & 2 **Section 3: 1, 2**	**Section 3: 3, 4 , 5**	**Section 3: 6**	**Section 3: 7**	**NO SCHOOL**

HOMEWORK 22. Section 3. Activities. Activities should be turned in on Friday.

ΟΝΟΜΑ: .....

(ONOMA) NAME

1. ΚΥΚΛΩΣΕ ΤΟ ΓΡΑΜΜΑ : Φ φ

(KYKLOSE TO YRAMMA:Φ φ) CIRCLE THE LETTER: Φ φ



2. ΓΡΑΨΕ: *(YRAPSE)* WRITE



3. ΜΕΤΡΗΣΕ ΚΑΙ ΓΡΑΨΕ ΤΟΥΣ ΑΡΙΘΜΟΥΣ. *(METRISE KE YRAPSE TOUS ARITHMOUS)* COUNT AND WRITE THE NUMBERS

ΗΛΙΟΣ ……..
(ILIOS) SUN

ΔΕΝΔΡΑ ……..
(PAPI) TREES

ΛΑΓΟΣ ……..
(LAYOS) HARE



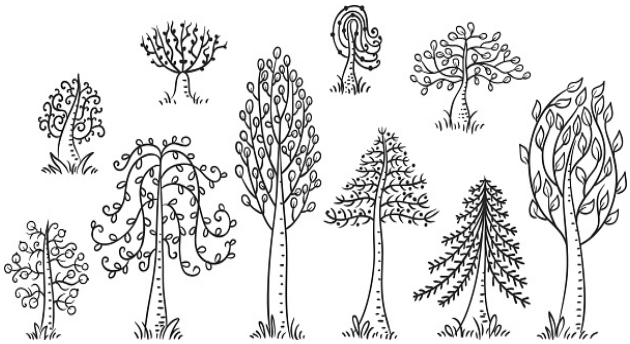

4. Η ΑΝΝΑ ΕΧΕΙ ΕΝΑ ΜΗΛΟ. ΤΡΩΕΙ ΤΟ ΜΗΛΟ. ΠΟΣΑ ΜΗΛΑ ΕΧΕΙ Η ΑΝΝΑ ΤΩΡΑ; ΒΑΛΕ «Χ» ΣΤΟ ΜΗΛΟ ΠΟΥ ΑΦΑΙΡΕΙΣ. ΓΡΑΨΕ ΤΟΝ ΑΡΙΘΜΟ. (I ANNA EHI ENA MILO. TROI TO MILO. POSA MILA EHI I ANNA TORA? (VALE "X" STO MILO POU AFERIS. YRAPSE TON ARITHMO) ANNA HAS AN APPLE. SHE EATS THE APPLE. HOW MANY APPLES DOES ANNA HAVE NOW? CROSS OUT THE APPLE YOU SUBTRACT. WRITE THE NUMBER.

1 – 1 = ……

MEION (MION) MINUS ΙΣΟΝ (ISON) EQUALS

5. ΜΕΤΡΗΣΕ. ΠΟΣΑ ΕΙΝΑΙ ΤΑ ΠΑΙΔΙΑ ΟΛΑ ΜΑΖΙ; ΠΟΣΑ ΦΕΥΓΟΥΝ; ΠΟΣΑ ΠΑΙΔΙΑ ΜΕΝΟΥΝ; ΒΑΛΕ «Χ» ΣΤΑ ΠΑΙΔΙΑ ΠΟΥ ΑΦΑΙΡΕΙΣ. ΓΡΑΨΕ ΤΟΥΣ ΑΡΙΘΜΟΥΣ. *(METRISE. POSA INE TA PETHIA OLA MAZI? POSA FEVYOUN? POSA MENOUN?* (VALE "X" STA PETHIA POU AFERIS. *YRAPSE TOUS ARITHMOUS). COUNT. HOW MANY* ARE THE CHILDREN ALL TOGETHER? HOW MANY CHILDREN ARE LEAVING? HOW MANY CHILDREN ARE LEFT? CROSS OUT THE NUMBER OF CHILDREN YOU NEED TO SUBTRACT. WRITE THE NUMBERS.



5

5 – 2 = ……

MEION (MION) MINUS ΙΣΟΝ (ISON) EQUALS

6. ΓΡΑΨΕ ΤΟΝ ΑΡΙΘΜΟ ΠΟΥ ΛΕΙΠΕΙ ΜΕΣΑ ΣΤΟ ΚΟΥΤΙ ΓΙΑ ΝΑ ΕΙΝΑΙ ΣΩΣΤΟ ΤΟ ΖΕΥΓΑΡΙ ΤΟΥ ΑΡΙΘΜΟΥ ΚΑΙ ΚΑΝΕ ΤΗΝ ΑΦΑΙΡΕΣΗ *(YRAPSE TON ARITHMO POU LIPI MESA STO KOUTI YIA NA INE SOSTO TO ZEVYARI TOU ARITHMOU* ΚΑΙ *KANE TIN AFERESI)* WRITE THE MISSING NUMBER IN THE BOX TO MAKE THE NUMBER PAIR TRUE AND DO THE SUBTRACTION.

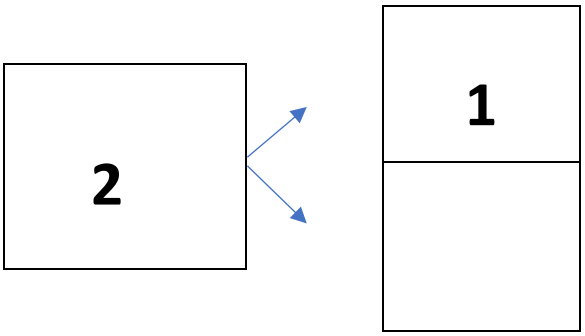

2 - 1 = ……

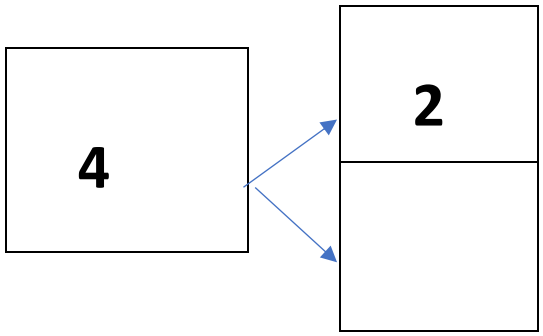

4 - 2 = ……

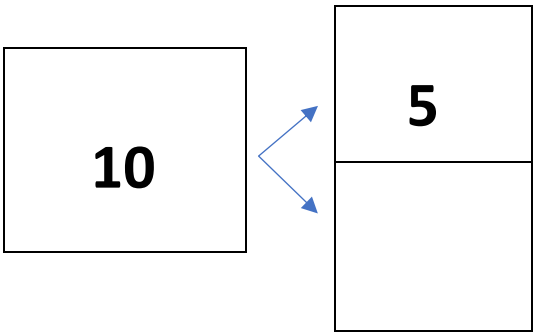

10 - 5 = ……

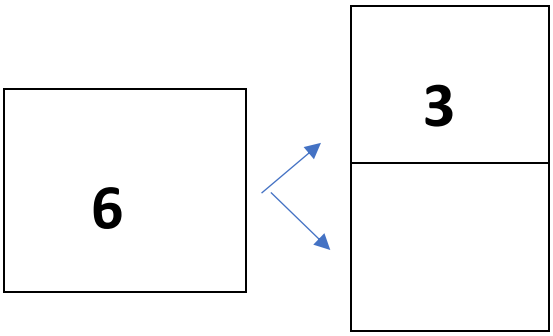

6 - 3 = ……

7. ΚΑΝΕ ΤΙΣ ΑΦΑΙΡΕΣΕΙΣ. DO THE SUBTRACTIONS.

3 -1= …….. **3 - 2= ……..** **4 - 1= ……..**

HOMEWORK 22. Sect. 2

Φ φ

-Να, ο φάρος με το φως.

Να, ο πατέρας.
- Ώρα για φαγητό.
Καλό ψάρι.
Μεγάλο ψάρι.