ΟΝΟΜΑ (NAME):_____

ΤΑΞΗ (CLASS): _____



Αγαθονήσι

Εργασία - (Homework) Greek Math
03/23/2026 - 03/26/2026
(2A,2B, 2C,2D,2E)

This week, students will continue working with three-digit numbers in Greek. They will practice putting numbers in order, counting forward and backward by 1 and 10, and understanding the value of each digit. These activities help build strong number sense and confidence in math.

Dear Parents,
This week's homework focuses on practicing three-digit numbers and place value.
Exercise 1 asks students to put numbers in order from smallest to largest and from largest to smallest.
Exercise 2 helps students practice counting by +1, -1, +10, and -10 to find missing numbers.
Exercise 3 asks students to find the value of the underlined digit (hundreds, tens, or ones).
These activities help students better understand numbers and build confidence in math while practicing Greek.
Please remind your child to bring the completed homework in their blue folder by 03.26.2026.
If you have any questions, feel free to contact me at:
stamatios.mavrogeorgis@archimedean.org
Warm regards,
Mr. Stamatios Mavrogeorgis

Άσκηση 1: Βάζω τους τριψήφιους στην σειρά ανάλογα με την αξία τους
φθίνουσα σειρά: descending order, αύξουσα σειρά: ascending order

μεγαλύτερο → μικρότερο (φθίνουσα σειρά)



μικρότερο → μεγαλύτερο (αύξουσα σειρά)



Άσκηση 2: Βρίσκω τους αριθμούς που λείπουν (+1. -1. +10, -10)

-10: 554		
-1: 563	564	+1: 565
+10: 574		

-10		
-1	701	+1
+10		

-10		
-1	240	+1
+10		

-10		
-1	170	+1
+10		

-10		
-1	879	+1
+10		

-10		
-1	600	+1
+10		

-10		
-1	490	+1
+10		

-10		
-1	510	+1
+10		

-10		
-1	395	+1
+10		

-10		
-1	990	+1
+10		

-10		
-1	603	+1
+10		

-10		
-1	380	+1
+10		

Άσκηση 3: Βρίσκω την αξία του κάθε υπογραμμισμένου ψηφίου

942	40
156	6
803	800
754	____
991	____
572	____

618	____
347	____
401	____
838	____
740	____
612	____

179	____
252	____
425	____
930	____
199	____
268	____