Name:_____ **Section:** _____

First Grade
American Math Homework #4

Hello Scholars and Parents. We will continue with Chapter 1 this week focusing on skip counting by 2's, 5's, and 10's, as well as finding 10 more and 10 less than a number from 1-120. Every class will begin with a review of key concepts, vocabulary words, and a spiral review of the 120 chart. Baseline diagnostic testing will begin Monday September 8. Please make sure scholars turn in their headphones to their HR teacher.

Vocabulary

- Skip Counting
- Pair
- Pattern
- Count
- Counting forwards
- Counting backwards
- More
- Less
- Before
- Between
- After



Notes

Students **MUST** prove and show all their work. If additional space is needed, please feel free to attach lined paper to the homework packet. **Failure to show your work will result in a lower grade**. Please complete the homework to the best of your abilities.

Parents please initial next to each day acknowledging your child has completed the assigned homework. **Homework will be checked daily in class. Completed homework packets are due on Monday September 15th, 2025 for a grade.**

Monday	September 8th – Page 299	_____
Tuesday	September 9th – Page 305	_____
Wednesday	September 10th – Page 311	_____
Thursday	September 11th – Page 399	_____
Friday	September 12th – Skip counting by 2's, 5's, 10's worksheet	_____

Name _____

Homework

I don't understand yet. | I understand some. | I understand.

Count forward by ones to write the missing numbers.

3. 56, _____, _____, _____, _____, _____

4. 47, _____, _____, _____, _____, _____

Count backward by ones to write the missing numbers.

5. _____, _____, _____, _____, _____, 115

6. _____, _____, _____, _____, _____, 24

Write the missing numbers in the chart.

7.

32		34	
	43		45

8.

	82		
91		93	

9. **Maintain Accuracy**

3 MTR Show your work.

You have 108 bouncy balls. You want 112.
How many more bouncy balls do you need?

Count and draw more balls to show 112:

© Big Ideas Learning, LLC

Name _____

Homework

I don't understand yet. | I understand some. | I understand.

Count by tens to write the missing numbers.

3. 62, _____, _____, _____, _____, _____

4. 43, _____, _____, _____, _____, _____

5. _____, _____, 30, _____, _____, _____

6. **Patterns** Write the missing numbers from the chart. Then count on by tens to write the next three numbers.

5 MTR

?	72	73	74	75	76	77	78	79	80
?	82	83	84	85	86	87	88	89	90

_____, _____, _____, _____, _____

7. **You Be the Teacher** Your friend counts by tens starting with 27. Is your friend correct? Show how you know.

4 MTR

27, 37, 47, 67, 77, 87

© Big Ideas Learning, LLC

Name _____

Homework

I don't understand yet. | I understand some. | I understand.

Count by twos to write the missing numbers.

3. 6, _____, _____, _____, _____, _____

4. _____, _____, 12, _____, _____, _____

Count by fives to write the missing numbers.

5. 75, _____, _____, _____, _____, _____

6. _____, _____, 20, _____, _____, _____

7. **Patterns** Count by twos until you reach 20. Circle each number you count. What do you notice?

5 MTR

1	2	3	4	5	6	7	8	9	10
11	12	13	14	15	16	17	18	19	20

8. **You Be the Teacher** Your cousin counts by fives starting with 40. Is your cousin correct? Show how you know.

4 MTR

40, 42, 44, 46, 48, 50

© Big Ideas Learning, LLC

Name _____

Homework

I don't understand yet. | I understand some. | I understand.

3.



1 more than 39 is _____. 10 more than 39 is _____.

1 less than 39 is _____. 10 less than 39 is _____.

4. **Model a Problem** Make a quick sketch for the number that is 10 less than the number shown by the model. What is the new number?

2 MTR

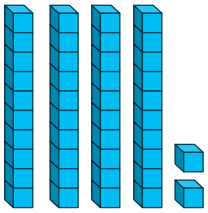

_____

Complete the table.

		1 more	1 less	10 more	10 less
5.	56				
6.	75				
7.	33				
8.	80				
9.	12				

© Big Ideas Learning, LLC

Name _____ Date _____

Skip Counting By 2s, 5s, and 10s.

Follow the counting instructions above each set.

1 Count by 2 from 34 to 50.

34								

2 Count by 2 from 10 to 22.

10						

3 Count by 10 from 21 to 111 .

21									

4 Count by 5 from 10 to 45.

10							

5 Count by 2 from 60 to 74.

60							

6 Count by 5 from 60 to 90.

60						

7 Count by 10 from 13 to 83.

13							

8 Count by 5 from 75 to 120.

75									

Let's Skip Count